Equivalent Fractions $\frac{1}{2}$

Shade $\frac{1}{2}$ of each shape. Look at how many squares are shaded (numerator) and the total amount of squares (denominator) and write the equivalent fraction underneath.

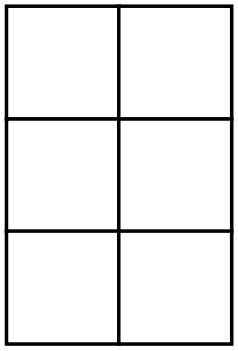

1. _____

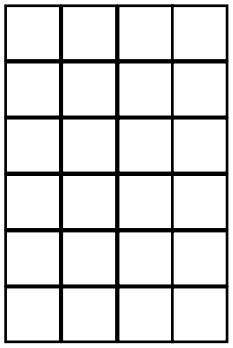

2. _____

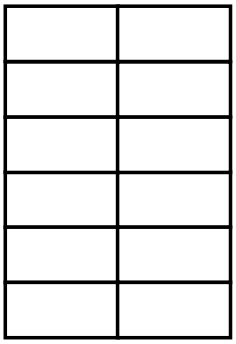

3. _____

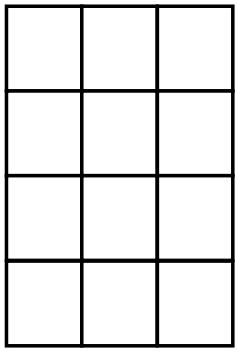

4. _____

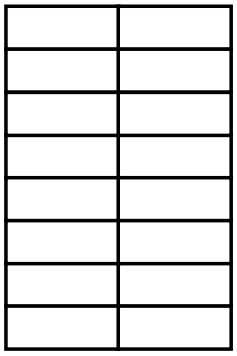

5. _____

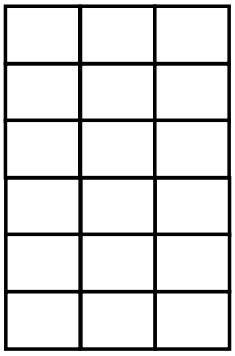

6. _____

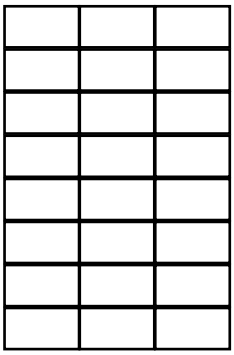

7. _____

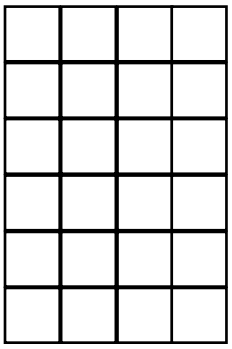

8. _____

visit twinkl.com

Equivalent Fractions $\frac{1}{3}$

Shade $\frac{1}{3}$ of each shape. Look at how many squares are shaded (numerator) and the total amount of squares (denominator) and write the equivalent fraction underneath.

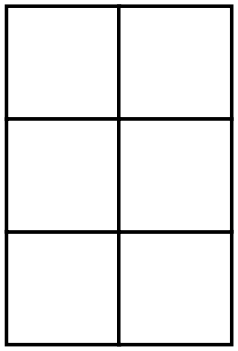

1. _____

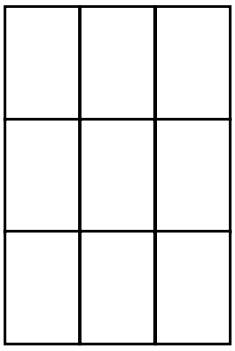

2. _____

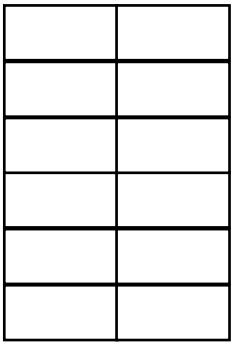

3. _____

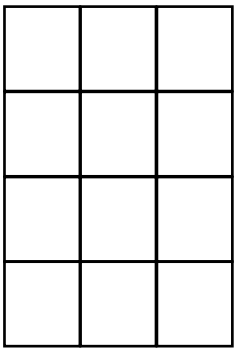

4. _____

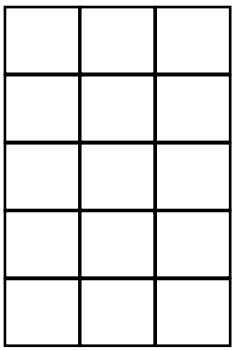

5. _____

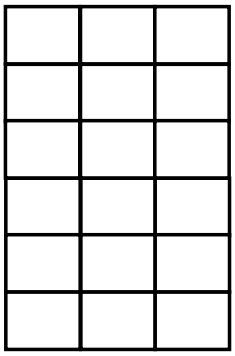

6. _____

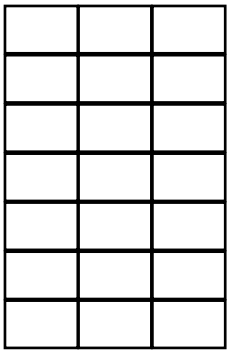

7. _____

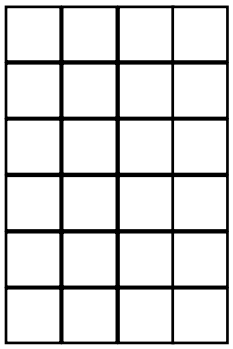

8. _____

The unshaded squares show $\frac{2}{3}$. Write the equivalent fractions:

visit twinkl.com

Equivalent Fractions $\frac{1}{4}$

Shade $\frac{1}{4}$ of each shape. Look at how many squares are shaded (numerator) and the total amount of squares (denominator) and write the equivalent fraction underneath.

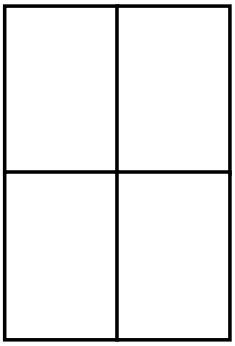

1. _____

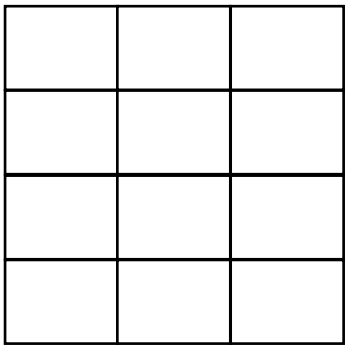

2. _____

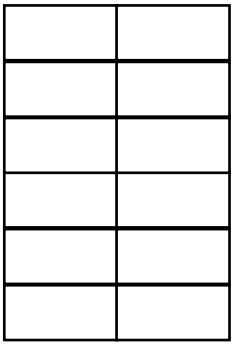

3. _____

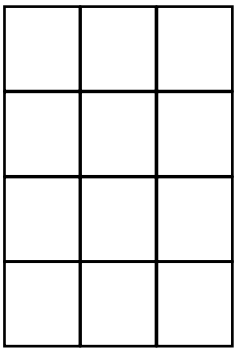

4. _____

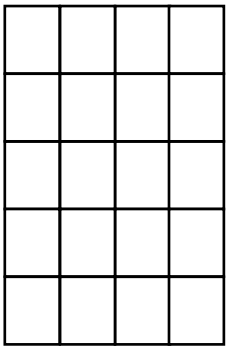

5. _____

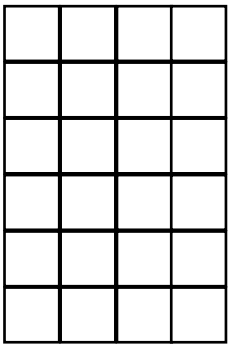

6. _____

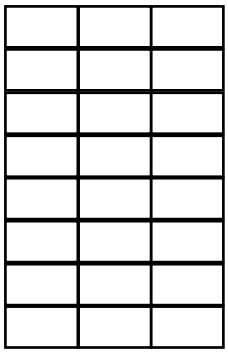

7. _____

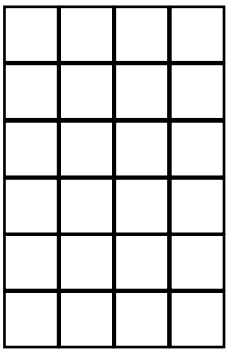

8. _____

The unshaded squares show $\frac{3}{4}$. Write the equivalent fractions:

visit twinkl.com

Equivalent Fractions $\frac{1}{10}$

Shade $\frac{1}{10}$ of each shape. Look at how many squares are shaded (numerator) and the total amount of squares (denominator) and write the equivalent fraction underneath.



1. _____



2. _____

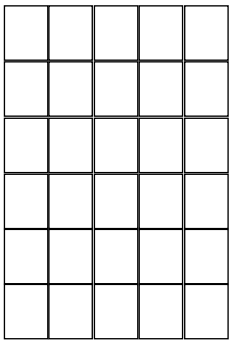

3. _____



4. _____



5. _____



6. _____



7. _____



8. _____

The unshaded squares show $\frac{9}{10}$. Write the equivalent fractions:

visit twinkl.com

Equivalent Fractions $\frac{1}{100}$

Shade $\frac{1}{100}$ of each shape. Look at how many squares are shaded (numerator) and the total amount of squares (denominator) and write the equivalent fraction underneath.



1. _____



2. _____



3. _____

The unshaded squares show 99/100. Write the equivalent fractions:

visit twinkl.com

Equivalent Fractions $\frac{1}{2}$ Answers

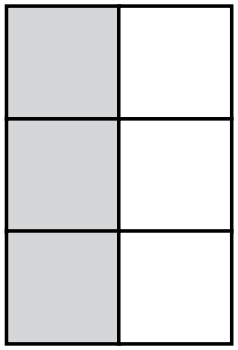

1. 3 squares $\frac{3}{6}$

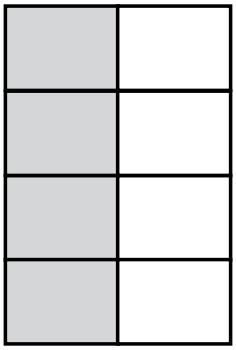

2. 4 squares $\frac{4}{8}$

3. 6 squares $\frac{6}{12}$

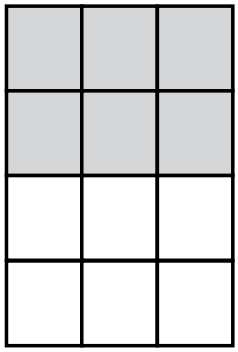

4. 6 squares $\frac{6}{12}$

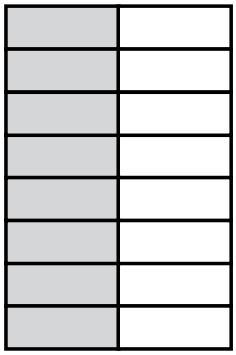

5. 8 squares $\frac{8}{16}$

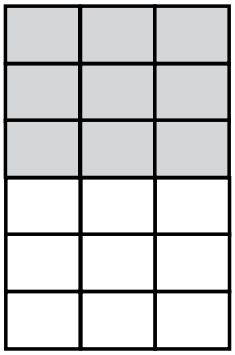

6. 9 squares $\frac{9}{18}$

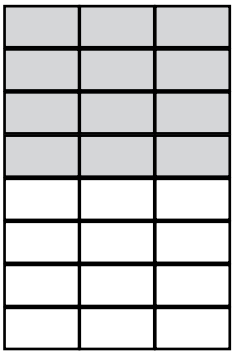

7. 12 squares $\frac{12}{24}$



8. 12 squares $\frac{12}{24}$

Equivalent Fractions $\frac{1}{3}$ Answers

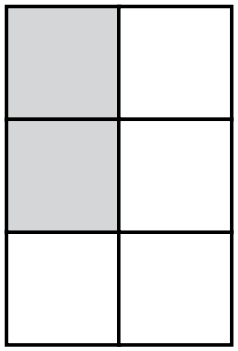

1. 2 squares $\frac{2}{6}$

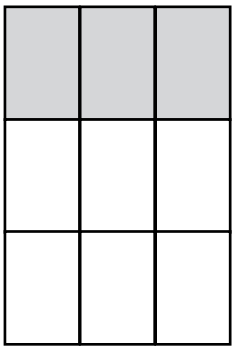

2. 3 squares $\frac{3}{9}$

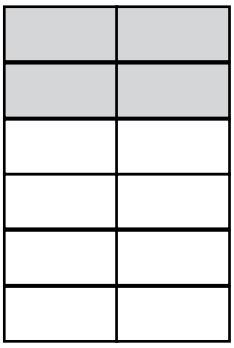

3. 4 squares $\frac{4}{12}$

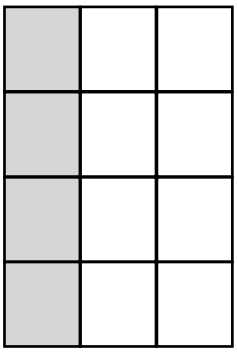

4. 4 squares $\frac{4}{12}$

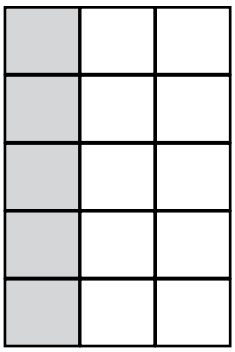

5. 5 squares $\frac{5}{15}$

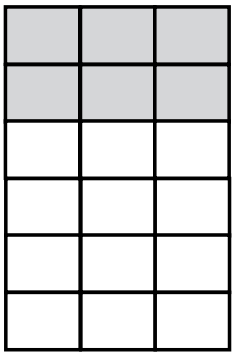

6. 6 squares $\frac{6}{18}$

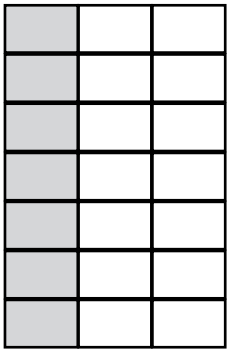

7. 7 squares $\frac{7}{21}$

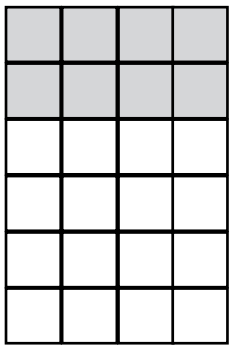

8. 8 squares $\frac{8}{24}$

The unshaded squares show 2/3. Write the equivalent fractions:

4/6, 6/9, 8/12, 10/15, 12/18, 14/21, 16/24

Equivalent Fractions $\frac{1}{4}$ Answers



1. 1 square $\frac{1}{4}$

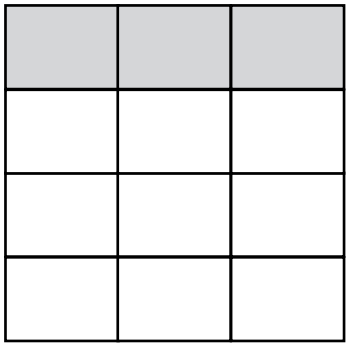

2. 3 squares $\frac{3}{12}$

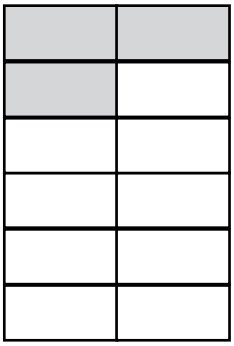

3. 3 squares $\frac{3}{12}$

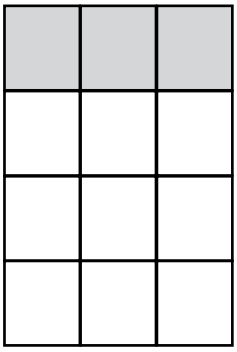

4. 3 squares $\frac{3}{12}$

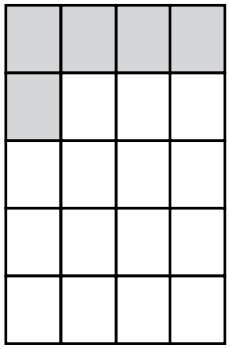

5. 5 squares $\frac{5}{20}$

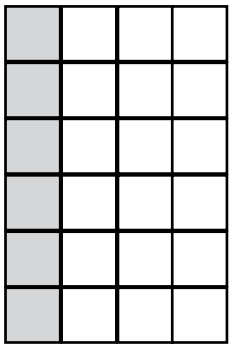

6. 6 squares $\frac{6}{24}$

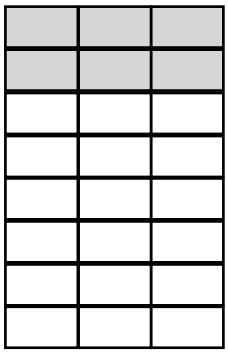

7. 6 squares $\frac{6}{24}$

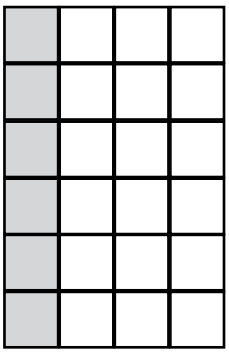

8. 6 squares $\frac{6}{24}$

The unshaded squares show $\frac{3}{4}$. Write the equivalent fractions:

6/8, 9/12, 12/16, 15/20, 18/24

Equivalent Fractions $\frac{1}{10}$ Answers

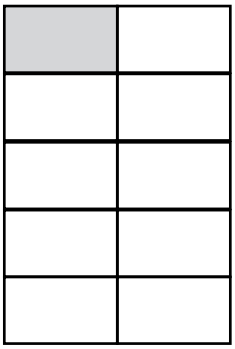

1. 1 square $\frac{1}{10}$

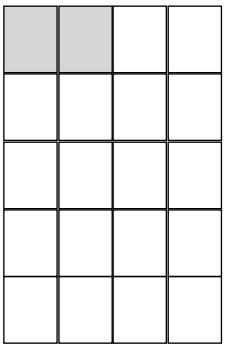

2. 2 squares $\frac{2}{20}$

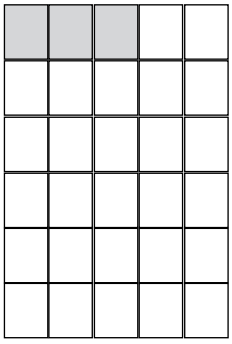

3. 3 squares $\frac{3}{30}$



4. 4 squares $\frac{4}{40}$



5. 5 squares $\frac{5}{50}$



6. 6 squares $\frac{6}{60}$



7. 7 squares $\frac{7}{70}$



8. 8 squares $\frac{8}{80}$

The unshaded squares show 9/10. Write the equivalent fractions:

18/20, 27/30, 36/40, 45/50, 54/60, 63/70, 72/80

Equivalent Fractions $\frac{1}{100}$ Answers



1. 1 square $\frac{1}{100}$



2. 2 squares $\frac{2}{200}$



3. 4 squares $\frac{4}{400}$

The unshaded squares show 9/10. Write the equivalent fractions:

198/200, 297/300, 396/400, 495/500